Provincia Hermanas Mirabal, República Dominicana

Liceo Científico Dr. Miguel Canela Lázaro

Centro de Excelencia Académica

( ) / 18

Matemática Práctica # 1 Segundo Parcial Grado: 1° Profesor: José Disla/ Pedro Ureña

Nombre: _____ E.A: _____Fecha: _____

Piensa, analiza y resuelve las siguientes situaciones. Escríbelo en tu cuaderno y lo desarrolla por puntos. 1pt. c/u

I) Escribe la fracción que representa la posición destacada en cada recta numérica.

a)

d)

b)

e)



c)

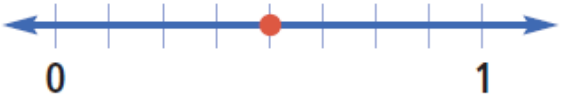

f)

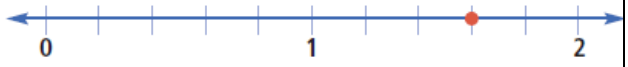

II) Sumar las siguientes fracciones con igual denominador

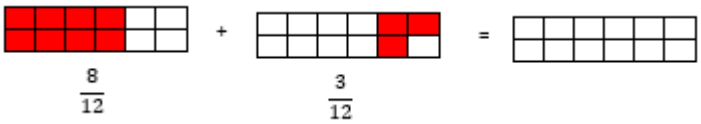

a) $\frac{8}{12}+\frac{3}{12}=$

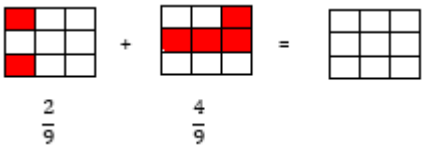

d) $\frac{2}{9}+\frac{4}{9}=$

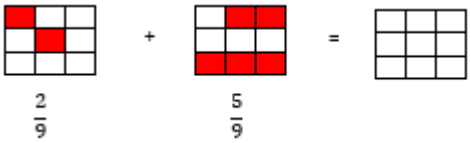

b) $\frac{2}{9}+\frac{5}{9}=$

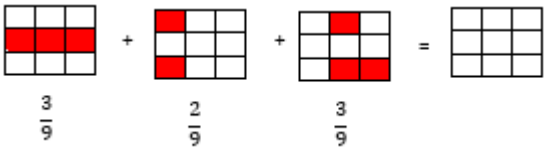

e) $\frac{3}{9}+\frac{2}{9}+\frac{3}{9}=$

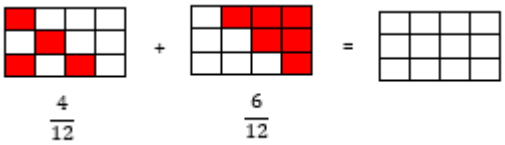

c) $\frac{4}{12}+\frac{6}{12}=$

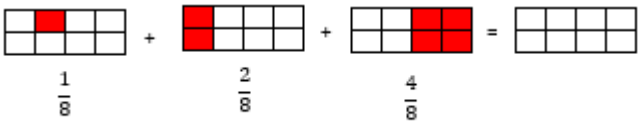

f) $\frac{1}{8}+\frac{2}{8}+\frac{4}{8}=$

III) Restar las siguientes fracciones con igual denominador

$\frac{3}{4}$ $\frac{1}{4}$

a) $\frac{3}{4} - \frac{1}{4} =$

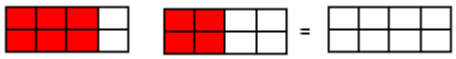

$\frac{6}{8}$ $\frac{4}{8}$

d) $\frac{6}{8} - \frac{4}{8} =$

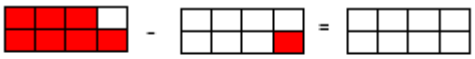

$\frac{7}{8}$ $\frac{1}{8}$

b) $\frac{7}{8} - \frac{1}{8} =$

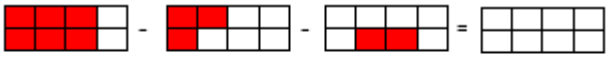

$\frac{6}{8}$ $\frac{3}{8}$ $\frac{2}{8}$

e) $\frac{6}{8} - \frac{3}{8} - \frac{2}{8} =$

$\frac{8}{10}$ $\frac{6}{10}$

c) $\frac{8}{10} - \frac{6}{10} =$

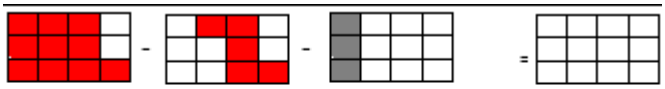

$\frac{10}{12}$ $\frac{5}{12}$ $\frac{3}{12}$

f) $\frac{10}{12} - \frac{5}{12} - \frac{3}{12} =$